

What fraction is shaded?

Stage 4 · Unit 7: Fractions

Basic ★

Name: _____ Date: _____ Score: ____ / 12

Count the equal parts (the bottom number) and the shaded parts (the top number).

1



$\frac{\square}{\square}$

2

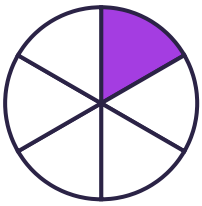

$\frac{\square}{\square}$

3

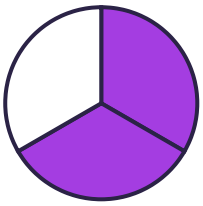

$\frac{\square}{\square}$

4



$\frac{\square}{\square}$

5



$\frac{\square}{\square}$

6



$\frac{\square}{\square}$

7



$\frac{\square}{\square}$

8



$\frac{\square}{\square}$

9

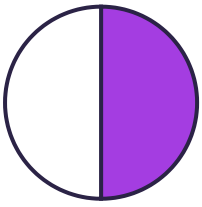

$\frac{\square}{\square}$

10



$\frac{\square}{\square}$

11



$\frac{\square}{\square}$

12

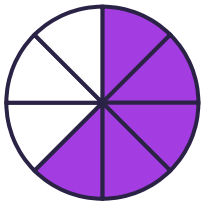

$\frac{\square}{\square}$