What fraction is shaded?

Stage 4 · Unit 7: Fractions

ANSWER KEY ✓

Name: Date: Score: ____ / 12

Count the equal parts (the bottom number) and the shaded parts (the top number).

1



$\frac{3}{8}$

2

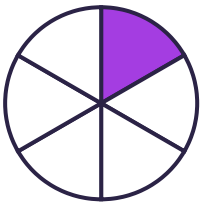

$\frac{1}{6}$

3

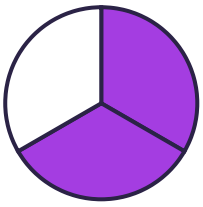

$\frac{2}{3}$

4



$\frac{4}{9}$

5



$\frac{2}{5}$

6



$\frac{3}{4}$

7



$\frac{3}{4}$

8



$\frac{1}{3}$

9

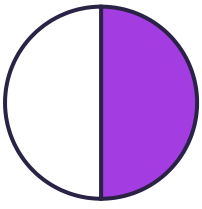

$\frac{1}{2}$

10



$\frac{7}{10}$

11



$\frac{5}{6}$

12

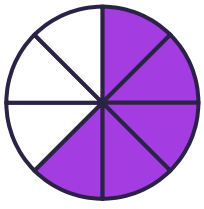

$\frac{5}{8}$