

Compare the fractions

Stage 4 · Unit 7: Fractions

Developing ★★

Name: _____ Date: _____ Score: ____ / 10

The bars are the same size. Look at the shaded parts, then write <, > or = in the box.

1

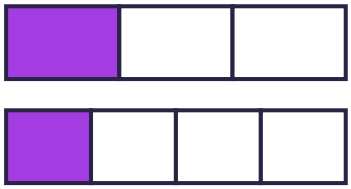

$\frac{1}{3}$ ☐ $\frac{1}{4}$

2

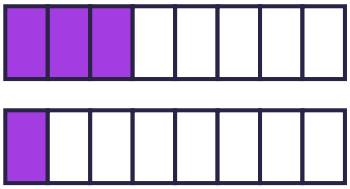

$\frac{3}{8}$ ☐ $\frac{1}{8}$

3

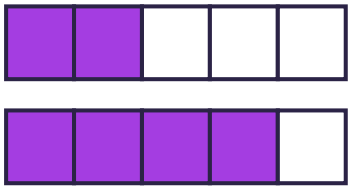

$\frac{2}{5}$ ☐ $\frac{4}{5}$

4

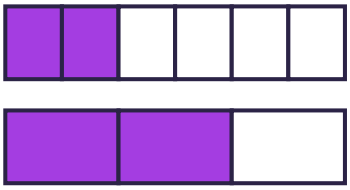

$\frac{2}{6}$ ☐ $\frac{2}{3}$

5

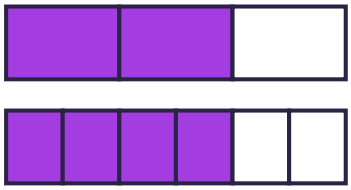

$\frac{2}{3}$ ☐ $\frac{4}{6}$

6

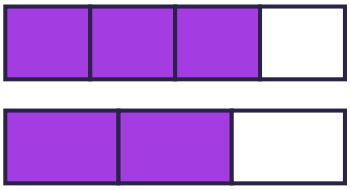

$\frac{3}{4}$ ☐ $\frac{2}{3}$

7

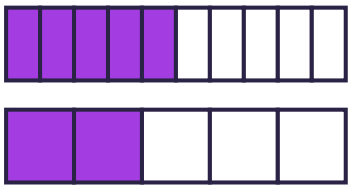

$\frac{5}{10}$ ☐ $\frac{2}{5}$

8

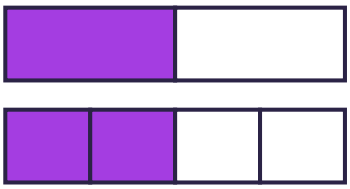

$\frac{1}{2}$ ☐ $\frac{2}{4}$

9

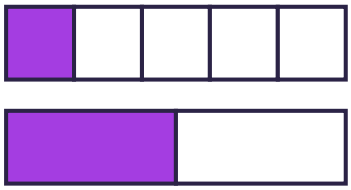

$\frac{1}{5}$ ☐ $\frac{1}{2}$

10

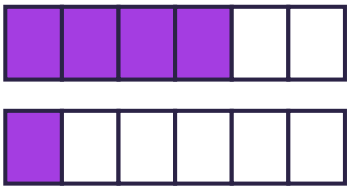

$\frac{4}{6}$ ☐ $\frac{1}{6}$