Name: _____ Date: _____

Put two angles together

Two angles side by side make one bigger angle. Add them to find the new angle, then say what kind of angle it is.



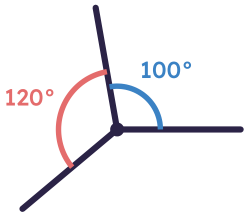

100° + 120° = _____ °

◯ acute ◯ right

◯ obtuse ◯ reflex

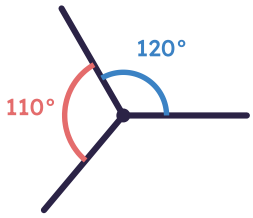

120° + 110° = _____ °

◯ acute ◯ right

◯ obtuse ◯ reflex

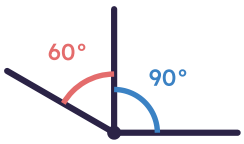

90° + 60° = _____ °

◯ acute ◯ right

◯ obtuse ◯ reflex

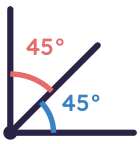

45° + 45° = _____ °

◯ acute ◯ right

◯ obtuse ◯ reflex

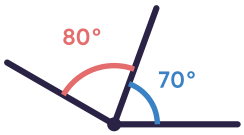

70° + 80° = _____ °

- ◯ acute
- ◯ right
- ◯ obtuse
- ◯ reflex

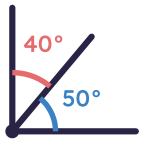

50° + 40° = _____ °

- ◯ acute
- ◯ right
- ◯ obtuse
- ◯ reflex