Name: _____ Date: _____

Shape detective

Count the sides and the vertices (corners). Is the shape regular (all sides and all angles equal)?



Shape	Sides	Vertices	Regular?
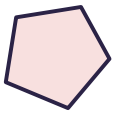	____	____	◯ Yes ◯ No
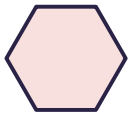	____	____	◯ Yes ◯ No
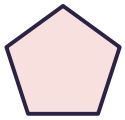	____	____	◯ Yes ◯ No
	____	____	◯ Yes ◯ No
	____	____	◯ Yes ◯ No
	____	____	◯ Yes ◯ No