Name: _____ Date: _____

Perimeter and area

Each square is 1 cm by 1 cm. Find the perimeter (all the way round, in cm) and the area (the number of squares, in cm²).



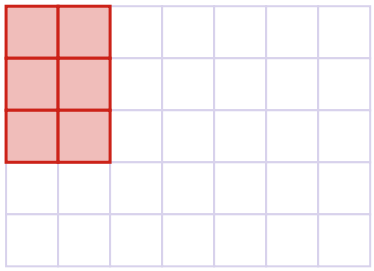

Perimeter 10 cm

Area 6 cm²

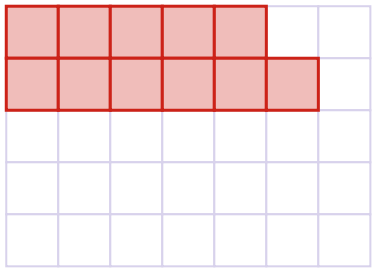

Perimeter 16 cm

Area 11 cm²

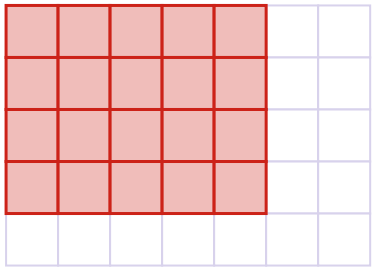

Perimeter 18 cm

Area 20 cm²

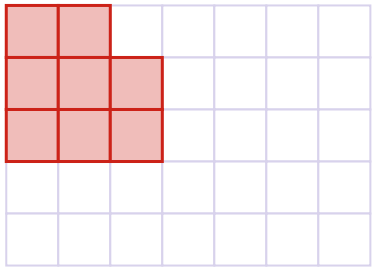

Perimeter 12 cm

Area 8 cm²