Name: _____ Date: _____

Name the shapes

Look at the sides and corners. Choose the name of each shape.



1



- ◯ octagon
- ◯ parallelogram
- ◯ triangle
- ◯ square

square

2

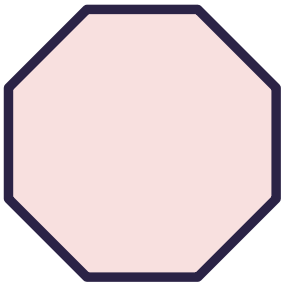

- ◯ square
- ◯ circle
- ◯ rhombus
- ◯ octagon

octagon

3

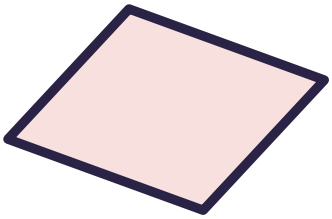

- ◯ parallelogram
- ◯ trapezium
- ◯ rectangle
- ◯ rhombus

parallelogram

4

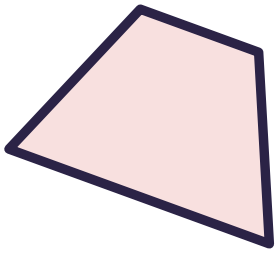

- ◯ rectangle
- ◯ circle
- ◯ rhombus
- ◯ trapezium

trapezium

5



- ◯ triangle
- ◯ rhombus
- ◯ trapezium
- ◯ square

rhombus

6

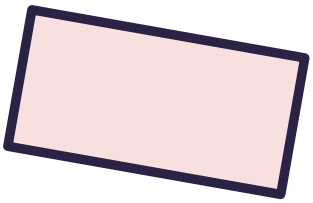

- ◯ octagon
- ◯ rectangle
- ◯ trapezium
- ◯ triangle

rectangle