Name: _____ Date: _____

Lines of symmetry

A line of symmetry folds a shape into two matching halves.
How many lines of symmetry does each shape have?



1

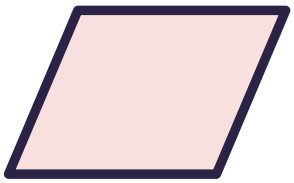

0 lines

2

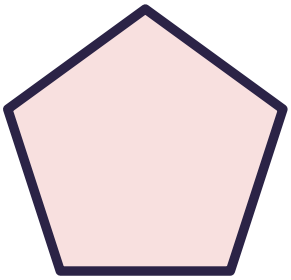

5 lines

3



1 lines

4

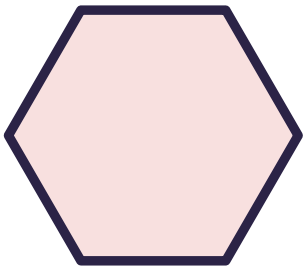

6 lines

5

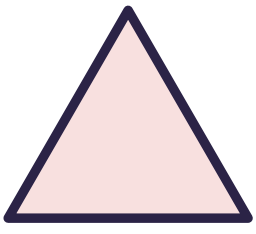

3 lines

6



2 lines