Name: _____ Date: _____

Part-whole: tens and ones

The whole is at the top. Its two parts are the tens and the ones. Fill in the missing number.



A. Complete each part-whole model.

1

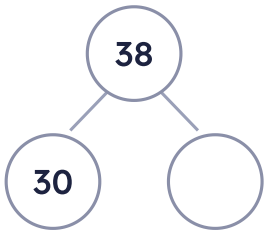

2

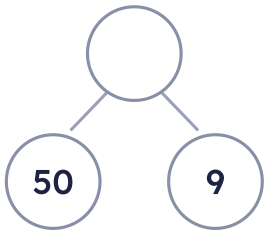

3

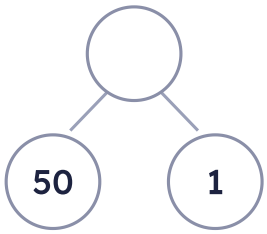

4

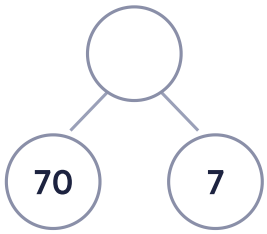

5

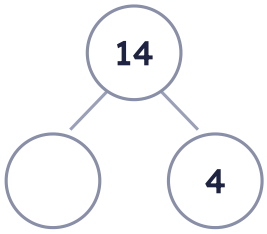

6

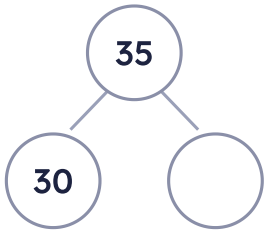

B. How many tens and ones?

7 73 = ____ tens + ____ ones

8 90 = ____ tens + ____ ones

9 74 = ____ tens + ____ ones

10 34 = ____ tens + ____ ones