Name: _____ Date: _____

Negative numbers

Numbers below zero are negative. On a number line they are to the left of 0.



A. What number is at the "?"

1

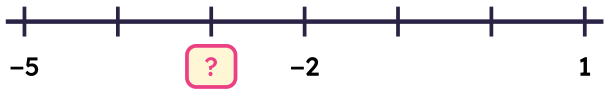

? = _____

2

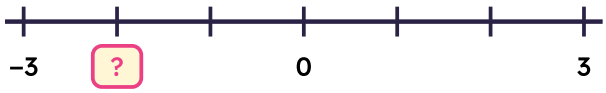

? = _____

3

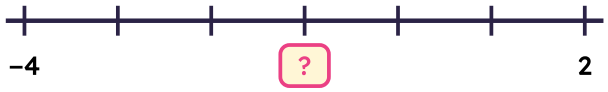

? = _____

4

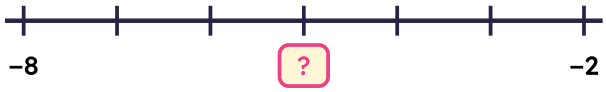

? = _____

5



? = _____

6

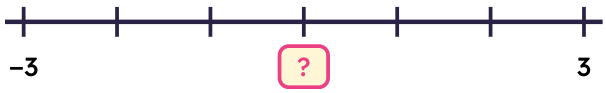

? = _____

B. Temperatures

1. The temperature is 6 °C. It rises by 4 degrees. What is the new temperature?

   _____ °C

2. The temperature is −6 °C. It falls by 3 degrees. What is the new temperature?

   _____ °C

3. The temperature is 3 °C. It rises by 4 degrees. What is the new temperature?

   _____ °C

4. The temperature is –1 °C. It rises by 7 degrees. What is the new temperature?

   _____ °C

5. Put these numbers in order from least to greatest: **0, 7, –7, –2, 2**

   _____ , _____ , _____ , _____ , _____