Name: _____ Date: _____

Hundreds, tens and ones

A flat is 1 hundred, a rod is 1 ten and a cube is 1 one. Count each kind, then add to find the total number.



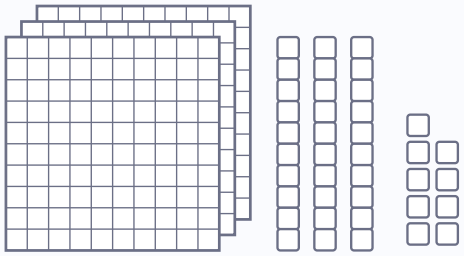

Hundreds	Tens	Ones
3	3	9

Total number 339

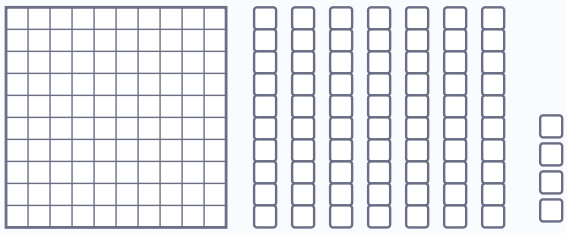

Hundreds	Tens	Ones
1	7	4

Total number 174

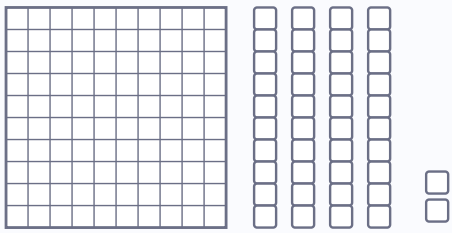

Hundreds	Tens	Ones
1	4	2

Total number 142

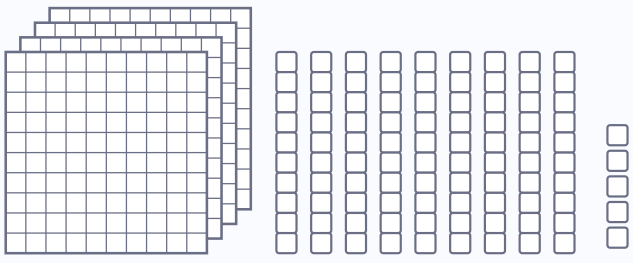

Hundreds	Tens	Ones
4	9	5

Total number 495