Name: _____ Date: _____

Count the blocks

A long rod is 1 ten. A small cube is 1 one. Count the tens, then the ones.



A. Count the blocks and write the number.

1

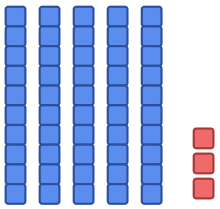

_____

2

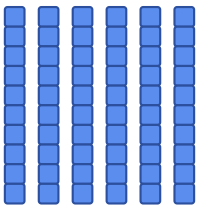

_____

3

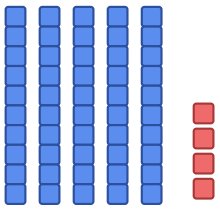

_____

4

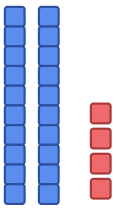

_____

5

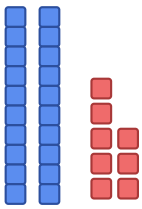

_____

6

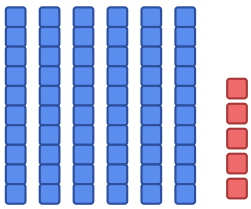

_____

B. Which number do the blocks show? Tick it.

7

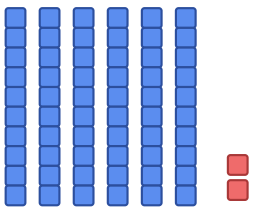

◯ 72 ◯ 62 ◯ 26

8



◯ 71 ◯ 17 ◯ 27