Name: _____ Date: _____

Count the blocks

A long rod is 1 ten. A small cube is 1 one. Count the tens, then the ones.



A. Count the blocks and write the number.

1

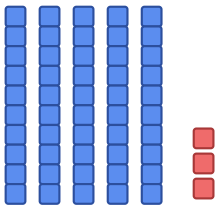

53

2

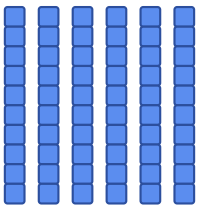

60

3

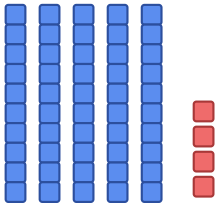

54

4

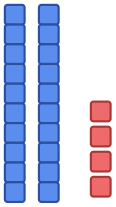

24

5

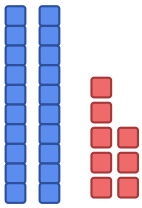

28

6

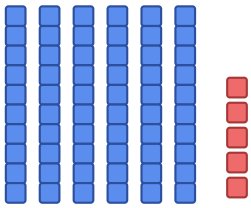

65

B. Which number do the blocks show? Tick it.

7

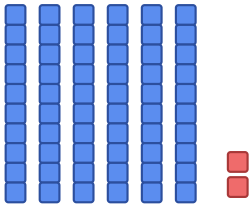

○ 72 ○ 62 ○ 26

62

8

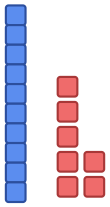

○ 71 ○ 17 ○ 27

17